Name: _____

Sr: 23042022-2608

April 23, 2022

MATHS WORKSHEET GENERATOR 11-PLUS SATS GCSES

1) 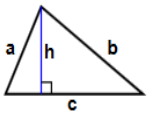

Find perimeter of triangle
h = 80 , a = 86 cm,
b = 95 cm, c = 100cm

Answer: _____

2) 80 - 16

Answer: _____

3) 170 ÷ 10

Answer: _____

4) 198 ÷ 18

Answer: _____

5) $5^{4}/_{7}$ x $2^{2}/_{8}$

Answer: _____

6) Convert the following fraction into a mixed number: $^{13}/_{8}$

Answer: _____

7) 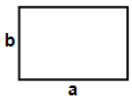

Find perimeter of rectangle having sides a = 37 m and b = 30 m

Answer: _____

8) 6% of 56

Answer: _____

9) 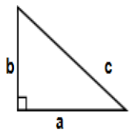

Find area of triangle
a = 29 m, b = 67 m

Answer: _____

10) 3% of 22

Answer: _____

11) 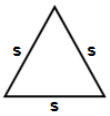

Find perimeter of triangle s = 41 in

Answer: _____

12) 0 x 1000

Answer: _____

13) A number was shared in the ratio 12:15. The smaller share was 12. What was the total amount shared?

Answer: _____

14) **1** $^{3}/_{8}$ **- 3** $^{4}/_{5}$

Answer: _____

15) 23 x 1000

Answer: _____

Copyright 2022 - Geek School Tutoring Limited

Name: _____

Sr: 23042022-2608

April 23, 2022

MATHS WORKSHEET GENERATOR 11-PLUS SATS GCSES

16) $^{19}/_{3} + {}^{1}/_{6}$

Answer: _____

17) 27 x 10

Answer: _____

18) 2 x 1000

Answer: _____

19) $^{2}/_{93}$ of 279

Answer: _____

20) Convert the following fraction into a mixed number: $^{9}/_{3}$

Answer: _____

21) 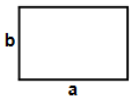

Find area of rectangle having sides a = 64 m and b = 35 m

Answer: _____

22) 68.1 - 24

Answer: _____

23) 78 x 76

Answer: _____

24) 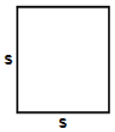

Find perimeter of square having each side (s) equals 94 in

Answer: _____

25) 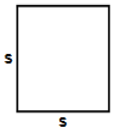

Find perimeter of square having each side (s) equals 79 cm

Answer: _____

26) Convert the following fraction into a mixed number: $^{7}/_{3}$

Answer: _____

27) 89 - 56

Answer: _____

28) 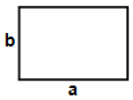

Find perimeter of rectangle having sides a = 37 in and b = 34 in

Answer: _____

29) $1^{3}/_{8} \times 5^{5}/_{6}$

Answer: _____

30) 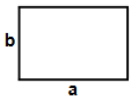

Find area of rectangle having sides a = 47 m and b = 7 m

Answer: _____

Copyright 2022 - Geek School Tutoring Limited

Name: _____

Sr: 23042022-2608

April 23, 2022

Total: ___ / 30

Copyright 2022 - Geek School Tutoring Limited

Name: _____

Sr: 23042022-2608

April 23, 2022

Answers:

1) 281cm	2) 64	3) 17	4) 11	5) $12^{15}/_{28}$	6) $1^{5}/_{8}$	7) 134m
8) 3.36	9) 971.5m	10) 0.66	11) 123in	12) 0	13) 27	14) $4^{17}/_{40}$
15) 23000	16) $6^{1}/_{2}$	17) 270	18) 2000	19) 6	20) 3	21) 2240m
22) 44.1	23) 5928	24) 376in	25) 316cm	26) $2^{1}/_{3}$	27) 33	28) 142in
29) $8^{1}/_{48}$	30) 329m					

Copyright 2022 - Geek School Tutoring Limited